Multi Tasking Non Technical Staff and Havaldar CBIC and CBN Examination 2024

Exam Date	13/11/2024
Exam Time	9:00 AM - 11:00 AM
Subject	MTS Non Tech Havaldar CBIC and CBN Examination 2024

Section : **Numerical and Mathematical Ability**

Q.1 **If the number of working staff in the company is increased by 20% and the salary per head is decreased by 20%, then the percentage of change in the total salary is:**

Ans A). decrease of 20% B). increase of 20% C). decrease of 4% D). increase of 4%

Correct Answer: C

Q.2 **Pankaj bought a watch at a price range from₹1,500 to₹3,000 which are sold at prices ranging from₹2,500 to₹3,500. If Pankaj sells such 10 watches, then the greatest possible profit (in ₹) he made with the transaction is:**

Ans A). 19,000 B). 23,854 C). 21,765 D). 20,000

Correct Answer: D

Q.3 **The graph shows the data of the number of accidents by three types of vehicles: X, Y and Z in four cities: P, Q, R and S. Study the given graph and answer the question that follows.**

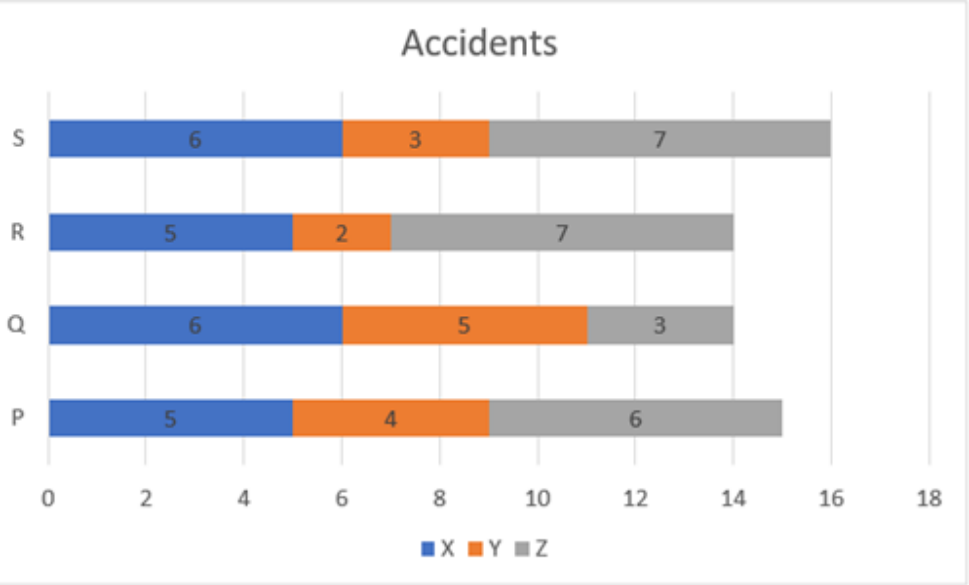

The correct increasing order of the cities as per the total number of accidents by all types of vehicles is:

Ans A). R, P, Q, S B). S, R, Q, P C). R, Q, P, S D). S, R, P, Q

Correct Answer: C

Q.4 **A 250-metre-long train running at a speed of 100 km/h crosses another train coming from the opposite direction at a speed of 62 km/h in 10 seconds. What is the length of the second train?**

Ans A). 230 metres B). 200 metres C). 240 metres D). 270 metres

Correct Answer: B

Q.5 **A sum of ₹12,000 becomes double at simple interest in 7 years at a certain rate of simple interest. Find the time (in years) it takes for the amount to become ₹60,000 at the same rate of interest.**

Ans A). 28 B). 30 C). 20 D). 25

Correct Answer: A

Q.6 A spherical metal ball is melted into a shape of cylinder mounted by a cone such that the base of cone exactly overlaps the top base of cylinder. The diameter of the cylinder and sphere is 4.2 m each. What is the height (in m) of the cone if the height of cylinder is 1.4 m?

Ans A). 0.7 B). 1.4 C). 4.2 D). 2.1

Correct Answer: C

Q.7 If $a = 2^2 \times 3^4 \times 5 \times 7^3$, $b = 2^3 \times 3^4 \times 5^2 \times 7^4$ and $c = 2^4 \times 3^2 \times 5^4 \times 7$, then the HCF of a, b and c is:

Ans A). 1260 B). 1575 C). 630 D). 180

Correct Answer: A

Q.8 The given table shows data for the month of May 2023.

Company	Total number of employees	Number of female employees
E	22,456	10,230
F	25,320	11,256
G	21,250	10,985
H	23,548	12,320

The total number of female employees in companies G and H together is what percentage of the total number of employees in company F? (Rounded off to 2 decimal places)

Ans A). 90.25% B). 85.36% C). 92.04% D). 82.07%

Correct Answer: C

Q.9 If a conical vessel is of height 12cm and radius 6cm, then the volume of the conical vessel is

Ans A). $254\pi\ cm^3$ B). $234\pi\ cm^3$ C). $144\pi\ cm^3$ D). $154\pi\ cm^3$

Correct Answer: C

Q.10 Vasudha claimed to sell her items at 18% above the cost of production, but used a weight that had 1 kg written on it, though it actually weighed y grams. If the actual profit percentage earned by Vasudha was $33\frac{1}{3}\%$, what is the value of y?

Ans A). 885 B). 890 C). 895 D). 880

Correct Answer: A

Q.11 The average of 7 numbers is 55. If the first 4 numbers are 48, 62, 135 and 74, then what will be the average of the remaining numbers?

Ans A). 22 B). 31 C). 25 D). 19

Correct Answer: A

Q.12 A retailer announces a discount of 25% for selling a mobile phone marked at ₹48,000. The cost price of the mobile phone is 45% below the marked price. He offers a further discount of 7.5% if the buyer returns his old mobile phone. What is the ratio of the profit percentages of the retailer with the return of the old mobile phone scheme to that of without the return of the old mobile phone, respectively?

Ans A). 32:23 B). 12: 11 C). 11: 12 D). 23:32

Correct Answer: D

Q.13 Two trains of lengths 310 m and 340 m, respectively, are 285 m apart. They start moving towards each other on parallel tracks, at the speeds of 151 km/h and 155 km/h, respectively. In how much time will the trains cross each other completely?

Ans A). 13 s B). 10 s C). 11 s D). 12 s

Correct Answer: C

Q.14 Find the number that must be added to the terms of the ratio 11 : 29 to make it equal to 11 : 20.

Ans A). 12 B). 10 C). 11 D). 9

Correct Answer: C

Q.15 A right circular solid metallic cone is 7.2 cm high and radius of its base 3.5 cm. It is melted and recast into two right circular solid metallic cones equal in all respects, each with base radius 2.1 cm and height 'h'. What is the value of 'h' (in cm)?

Ans A). 14 B). 10 C). 21 D). 12

Correct Answer: B

Q.16 A shopkeeper of a subsidised canteen mixed three varieties of rice, X, Y and Z, in the ratio of 4 : 1 : 3 to make a packet of 4 kg of rice. The cost prices per kg of X, Y and Z varieties of rice are ₹2, ₹4 and ₹6, respectively. What is the cost price (in ₹) of the packet of rice?

Ans A). 10 B). 15 C). 30 D). 18

Correct Answer: B

Q.17 Find the simple interest (in ₹) on ₹2500 as a sum borrowed at 7% per year rate of interest for 2 years.

Ans A). 390 B). 290 C). 310 D). 350

Correct Answer: D

Q.18 The average weight of 6 children increases by 1.5 kg when a new child comes in place of one of them weighing 12 kg. The weight of the new child is:

Ans A). 21 kg B). 14 kg C). 22 kg D). 14.5 kg

Correct Answer: A

Q.19 The average height of a group of 10 students is 172 cm. Two more students of height 178 cm and 165 cm joined the group and 3 students of average height 160 cm leave the group. What is the new average height (in cm, rounded off to 1 decimal place) of the group after the changes?

Ans A). 174.6 B). 170.5 C). 175.9 D). 169.7

Correct Answer: C

Q.20 Find the simple interest (in ₹) on ₹2500 as a sum borrowed at 7% per year rate of interest for 4 years.

Ans A). 640 B). 660 C). 700 D). 740

Correct Answer: C

Section : Reasoning Ability and Problem Solving

Q.1 Which of the following equations is correct by interchanging the '+' and '×' signs and the '4' and '5' numbers?

Ans A). 20 + 5 × 4 = 85 B). 5 + 15 × 4 = 50 C). 5 × 4 + 10 = 40 D). 10 × 4 + 5 = 60

Correct Answer: A

Q.2 What will come in place of the question mark (?) in the following equation, if '+' and '−' are interchanged and '×' and '÷' are interchanged?

392 × 7 − 2 ÷ 12 + 80 = ?

Ans A). 0 B). 2 C). 8 D). 4

Correct Answer: A

Q.3 In a certain code language, 'DAYS' is coded as '3917' and 'YOLK' is coded as '2496'.What is the code for 'Y' in that language?

Ans A). 1 B). 4 C). 2 D). 9

Correct Answer: D

Q.4 Select the figure from among the given options that can replace the question mark (?) in the following series and complete the pattern.

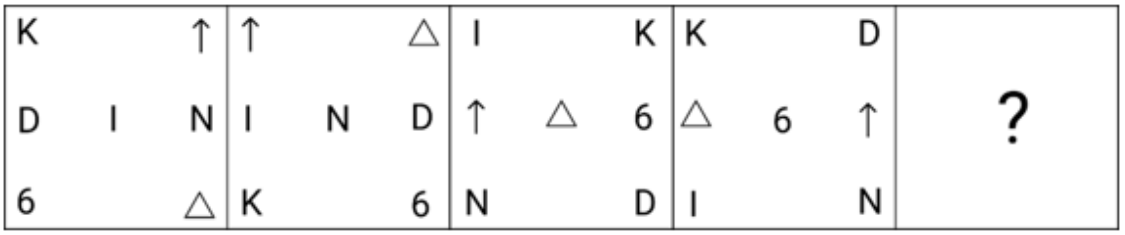

Ans

A). 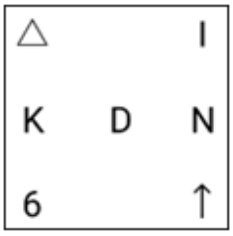

B). 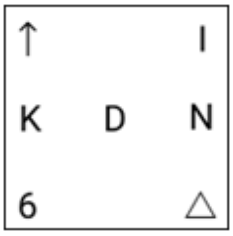

C). 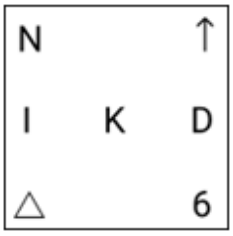

D). 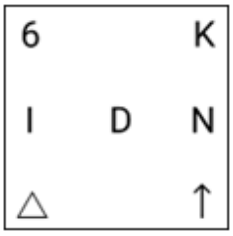

Correct Answer: A

Q.5 4 is related to 70 following a certain logic. Following the same logic, 8 is related to 518. To which ofthe following is 6 related, following the same logic?(NOTE: Operations should be performed on the whole numbers, without breaking down the numbersinto its constituent digits. E.g. 13 – Operations on 13 such as adding /subtracting /multiplying etc. to 13can be performed. Breaking down 13 into 1 and 3 and then performing mathematical operations on 1and 3 is not allowed)

Ans A). 226 B). 219 C). 222 D). 216

Correct Answer: C

Q.6 **In a certain code language, 'YATCH' is coded as 'RTMVA' and 'CAT' is coded as 'VTM'. What is the code for 'ANAMOLIES' in the given code language?**

Ans A). TGTEHEBXL B). TGTFGEBXL C). TGTFHEBXL D). TGSFHEBXL

Correct Answer: C

Q.7 **Select the figure from the given options, which when put in place of the question mark (?) will logically complete the series.**

Ans

A).

B).

C). 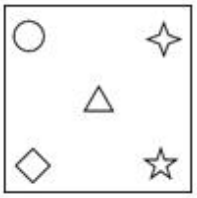

D).

Correct Answer: D

Q.8 **What should come in place of the question mark (?) in the given series?**

118 122 130 142 158 ?

Ans A). 178 B). 182 C). 186 D). 166

Correct Answer: A

Q.9 **Select the correct mirror image of the given figure when the mirror is placed at MN as shown below.**

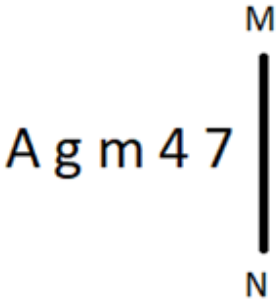

Ans A). 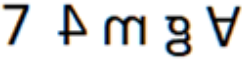 B). 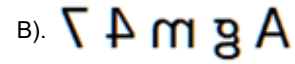 C). 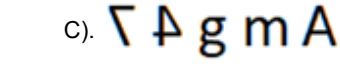 D). 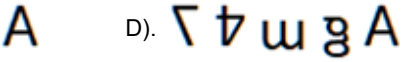

Correct Answer: B

Q.10 **Select the option figure that will replace the question mark (?) in the figure given below to complete the pattern.**

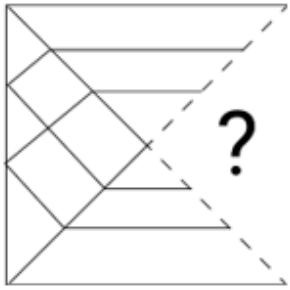

Ans

A).

B). 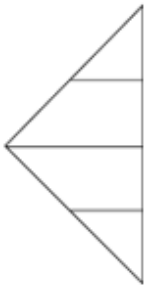

C). 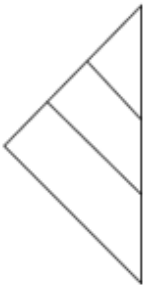

D). 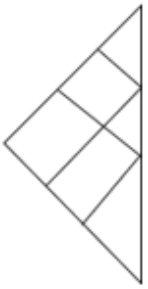

Correct Answer: D

Q.11 **LO15 is related to OR30 in a certain way. In the same way, SV25 is related to VY50. To which of the following is TW35 related, following the same logic?**

Ans A). WZ70 B). WA70 C). WZ17 D). AZ17

Correct Answer: A

Q.12 **This question has two statements followed by two conclusions numbered I and II. You have to take the given statements to be true even if they seem to be at variance from commonly known facts. You have to decide which of the given conclusions logically follow(s) from the given statements.**
Statements:
All arrows are swords.
Some swords are dragons.
Conclusions
(I) Some swords are arrows.
(II) Some dragons are not swords.

Ans A). Neither conclusion (I) nor (II) follows B). Both conclusions (I) and (II) follow C). Only conclusion (II) follows D). Only conclusion (I) follows

Correct Answer: D

Q.13 **Seven people A, B, C, D, E, F and G are sitting around a circular table, facing the centre (but not necessarily in the same order). Exactly three people are sitting between E and B when counted from the right of E. Both G and D are immediate neighbours of F. C is sitting to the immediate left of A. D and E are not sitting next to each other. The position of how many persons will remain unchanged, excluding A, if all the persons are arranged in the English alphabetical order, in clockwise direction, starting from A?**

Ans A). 1 B). 2 C). 4 D). 3

Correct Answer: A

Q.14 **Three statements are given, followed by two conclusions numbered 1, and 2. Assuming the statements to be true, even if they seem to be at variance with commonly known facts, decide which of the conclusions logically follow(s) from the statements.**
Statements:
No Doctor is a Nurse
Some Nurses are Patients
Some Patients are Medicines
Conclusions:
1. Some Patients are not Doctors
2. Some Nurses are Medicines

Ans A). Neither conclusion 1 nor 2 follows B). Only conclusion 1 follows C). Only conclusion 2 follows D). Both conclusions 1 and 2 follow

Correct Answer: B

Q.15 **A, B, C, D, E, F and G are sitting around a circular table facing the centre (but not necessarily in the same order). G sits second to the left of F, who is third to the left of D. C sits third to the right of B, who is not an immediate neighbour of E. A sits second to the right of B.**
Who is immediate right of E?

Ans A). A B). D C). G D). B

Correct Answer: C

Q.16 **NLRP is related to USYW in a certain way based on the English alphabetical order. In the same way, KIOM is related to RPVT. To which of the following is GEKI related, following the same logic?**

Ans A). NLPR B). LNRP C). NLRP D). LNPR

Correct Answer: C

Q.17 **What should come in place of the question mark (?) in the given series based on the English alphabetical order?**

RJK, PMI, NPG, LSE, ?

Ans A). KVD B). KWC C). JVC D). KVC

Correct Answer: C

Q.18 **In a certain code language, 'MINT' is coded as '9735' and 'NEAR' is coded as '4568'.**
What is the code for 'N' in the given code language?

Ans A). 3 B). 5 C). 6 D). 4

Correct Answer: B

Q.19 **In a certain code language, 'FISH' is coded as '6482' and 'SANE' is coded as '7691'.**
What is the code for 'S' in the given code language?

Ans A). 8 B). 7 C). 6 D). 9

Correct Answer: C

Q.20 **19 is related to 39 following a certain logic. Following the same logic, 1 is related to 3. To which of the following is 3 related following the same logic?(NOTE: Operations should be performed on the whole numbers, without breaking down the numbersinto its constituent digits. E.g. 13 – Operations on 13 such as adding /subtracting /multiplying etc. to 13can be performed. Breaking down 13 into 1 and 3 and then performing mathematical operations on 1and 3 is not allowed)**

Ans A). 7 B). 9 C). 11 D). 8

Correct Answer: A

Section : **General Awareness**

Q.1 Which is the jet stream that brings Western disturbances in India?

Ans A). Easterly jet stream B). Westerly jet stream C). South polar jet stream D). North polar jet stream

Correct Answer: B

Q.2 Aparna Satheesan, a recipient of 2021 Abhinandan Saroja National award by National Institute of Classical Dance, is an exponent of _____ and Kuchipudi.

Ans A). Bharatanatyam B). Kathak C). Manipuri D). Mohiniyattam

Correct Answer: A

Q.3 According to Census of India 2011, which pair of states recorded the highest population density (persons/km^2) in India?

Ans A). Bihar and Kerala B). West Bengal and Uttar Pradesh C). Bihar and West Bengal D). Uttar Pradesh and Haryana

Correct Answer: C

Q.4 Identify the place where the West Central Railway Zone headquarters is located.

Ans A). Jabalpur B). Jodhpur C). Bhopal D). Jaipur

Correct Answer: A

Q.5 Which of the following Rashtrakuta rulers performed the ceremony called 'Hiranya Garbha'?

Ans A). Krishna I B). Dantidurga C). Govind III D). Dhruva I

Correct Answer: B

Q.6 Who can exercise a casting vote in the case of an equality of votes in Lok Sabha?

Ans A). Speaker of Lok Sabha B). President C). Prime Minister D). Vice President

Correct Answer: A

Q.7 The autobiography of Sam Pitroda is called:

Ans A). In the afternoon of time B). Dreaming Big: My Journey to Connect India C). The Substance and The Shadow D). Beyond the lines

Correct Answer: B

Q.8 On which of the following dates did the British Empire transfer its powers to the Constituent Assembly in India?

Ans A). 2nd October B). 15th August C). 14th November D). 26th January

Correct Answer: B

Q.9 The Right to Freedom of Religion is covered under which Articles of the Constitution of India?

Ans A). Articles 25-28 B). Articles 21-24 C). Articles 29-32 D). Articles 24-27

Correct Answer: A

Q.10 A little child is a very picky eater and hates drinking milk and milk products. When he lost his baby tooth, permanent teeth took a very long time to come up in its place. What could be the probable reason behind this?

Ans A). Vitamin Deficiency B). Sugar Deficiency C). Calcium Deficiency D). Protein Deficiency

Correct Answer: C

Q.11 The 'Quit India Movement' was launched under the leadership of _____.

Ans A). Jawaharlal Nehru B). Mahatma Gandhi C). Subhash Chandra Bose D). Muhammad Ali Jinnah

Correct Answer: B

Q.12 On May 23, 2023, who assumed the position of Chairperson at the Competition Commission of India?

Ans A). Subhash Chandra Garg B). Neha Bhatia C). NK Singh D). Ravneet Kaur

Correct Answer: D

Q.13 Which of the following Indian philosophical systems and its widely acknowledged proponents is INCORRECTLY paired?

Ans A). Yoga - Patanjali B). Purva Mimansa - Jaimini C). Nyaya - Gotama D). Vaisheshika - Vyasa

Correct Answer: D

Q.14 Which of the following statements is/are true about public goods?
I. Rivalrous in consumption
II. Non-excludability
III. Positive marginal cost

Ans A). Only I B). Only II and III C). Only I and III D). Only II

Correct Answer: D

Q.15 Which of the following folk dances of Jharkhand, Odisha and West Bengal region is on the Representative List of the Intangible Cultural Heritage of Humanity?

Ans A). Kummi B). Chhau C). Karma Naach D). Dadra

Correct Answer: B

Q.16 Where did the IBA Women's World Boxing Championships 2023 take place in India?

Ans A). Mumbai B). New Delhi C). Kolkata D). Bengaluru

Correct Answer: B

Q.17 **The rifle (in the shooting sport) is single-loaded in _____-millimetre calibre (the inner diameter of a gun barrel), which is used across all events.**

Ans A). 5.6 B). 4.8 C). 4.5 D). 5.1

Correct Answer: A

Q.18 **In Harappan civilisation, which material was NOT used in the construction of buildings?**

Ans A). Wood B). Burnt mud-bricks C). Iron D). Gypsum mortar

Correct Answer: C

Q.19 **The National Food Security Act (NFSA) was enacted in which year by the Government of India?**

Ans A). 2001 B). 2013 C). 2008 D). 2005

Correct Answer: B

Q.20 **As of July 2023, how many products were notified under the 'One District, One Product' scheme as per the information provided by the Ministry of Food Processing Industries, Government of India?**

Ans A). 132 B). 125 C). 135 D). 137

Correct Answer: D

Q.21 **Vibration or wave caused by the sudden movement of tectonic plates within the earth that can travel through and around the earth is called:**

Ans A). Seismic Wave B). Main Shock C). Foreshock D). Upheaval

Correct Answer: A

Q.22 **Which of the following agreements led Mahatma Gandhi to attend the Second Round Table Conference?**

Ans A). Gandhi Irwin Pact B). Poona Pact C). Lucknow Pact D). Pact of Paris

Correct Answer: A

Q.23 **What is the primary source of energy for most ecosystems on Earth?**

Ans A). Geothermal heat B). Tidal energy C). Wind D). Sunlight

Correct Answer: D

Q.24 **Who was the progenitor of the prolific Jaipur-Atrauli gharana?**

Ans A). Ustad Alladiya Khan B). Ustad Vilayat Khan C). Ustad Ali Akbar Khan D). Ustad Mustaq Ali Khan

Correct Answer: A

Q.25 **0.25 g of an organic compound gave 0.20 g of CO_2 after complete combustion. The percentage composition of carbon is _____.**

Ans A). 4.60% B). 21.82% C). 80.00% D). 78.18%

Correct Answer: B

Section : **English Language and Comprehension**

Q.1 **Select the most appropriate option to fill in the blank.**

The philanthropist's _____ donations significantly improved the quality of life in the community.

Ans A). substantial B). meagre C). parsimonious D). redundant

Correct Answer: A

Q.2 **Select the INCORRECTLY spelt word..**

Ans A). Peaceful B). Lovable C). Joyful D). Faithfull

Correct Answer: D

Q.3 **Select the most appropriate option to fill in the blank.**

She is _____ of spiders.

Ans A). interest B). afraid C). fear D). frightening

Correct Answer: B

Q.4 **Select the most appropriate meaning of the given idiom.**

Dig up dirt

Ans A). To uncover negative information about someone or something. B). Find and disclose evidence C). Enquire about a missing person D). Hide and protect vital evidence

Correct Answer: A

Q.5 **Select the most appropriate option to fill in the blank.**

Following weeks of intense training, the athlete _____ in the championship.

Ans A). were competing B). have been competing C). competed D). have competed

Correct Answer: C

Q.6 Select the INCORRECTLY spelt word.

Ans A). Obedence B). Aggravate C). Fabulous D). Tremendous

Correct Answer: A

Q.7 Select the grammatically correct sentence from the given options.

These are the works of a great poet Tagore.

Ans A). These are the works of that great poet Tagore. B). These are the works of an great poet Tagore.
C). These are the works of this great poet Tagore. D). These are the works of the great poet Tagore.

Correct Answer: D

Q.8 Select the option that is OPPOSITE in meaning to the underlined word in the given sentence.

The state played only a <u>modest</u> part in the outstanding advancement of modern morality.

Ans A). Unimpressive B). Boastful C). Moderate D). Humble

Correct Answer: B

Q.9 Select the correct spelling of the incorrectly spelt word in the given sentence.

She is an independant writer.

Ans A). Independent B). Indipendant C). Indipendent D). Independant

Correct Answer: A

Q.10 Select the option that best expresses the meaning of the given idiom.

When pigs fly

Ans A). In unity B). In due course of time C). Just impossible D). Correct approach

Correct Answer: C

Q.11 Select the most appropriate homophone to fill in the blank.While learning to drive, Shivani met with an accident because she couldn't hit the _____.

Ans A). break B). brake C). brick D). brack

Correct Answer: B

Q.12 Select the option that can be used as a one-word substitute for the underlined word.
"He was notorious for his <u>avaricious</u> behaviour, always seeking ways to accumulate more wealth."

Ans A). notorious B). greedy C). sloth D). generous

Correct Answer: B

Q.13 The following sentence has been split into four segments. Identify the segment that contains a grammatical error.

The residents of Rameswaram / about the 1940s were quite / orthodox, but were also / tolerant of other communities.

Ans A). about the 1940s were quite B). orthodox, but were also C). The residents of Rameswaram D). tolerant of other communities

Correct Answer: A

Q.14 Select the most appropriate option to fill in the blank.
We are planning to see an _____ perform a symphony.

Ans A). opera B). orchestra C). actor D). actress

Correct Answer: B

Q.15 Select the most appropriate option to fill in the blank.

The cat likes to _____ in the sun during the afternoon.

Ans A). lye B). lei C). lie D). lay

Correct Answer: C

Q.16 Select the most appropriate option to fill in the blank.

The movie was so boring that I fell _____.

Ans A). slept B). sleep C). asleep D). sleeping

Correct Answer: C

Q.17 The following sentence has been divided into parts. One of them contains an error. Select the part that contains the error from the given options.

After months of / meticulous planning and hard work, / a team successfully launched / their innovative product to the market.

Ans A). their innovative product to the market. B). a team successfully launched C). meticulous planning and hard work, D). After months of

Correct Answer: B

Q.18 Parts of the following sentence have been given as options. Select the option that contains an error.
Dr. Oppenheimer is the exceptional movie of all the movies in recent times.

Ans A). of all the movies B). Dr. Oppenheimer is C). in recent times D). the exceptional movie

Correct Answer: D

Q.19 Select the most appropriate ANTONYM of the given word.
Cacophony

Ans A). Discord B). Noise C). Dissonance D). Harmony

Correct Answer: D

Q.20 Select the grammatically correct sentence from the given options.

Ans A). A salesman insisted that the payment against an purchase should be done by using the bank card.

B). The salesman insisted that the payment against the purchase should be done by using a bank card.

C). The salesman insisted that a payment against the purchase should be done by using an bank card.

D). A salesman insisted that a payment against a purchase should be done by using a bank card.

Correct Answer: B

Comprehension:

In the following passage, some words have been deleted. Read the passage carefully and select the most appropriate option to fill in each blank.

In terms of technical difficulty, Nanga Parbat, the world's ninth (1)_____ peak, competes with K2. The first (2)_____ to the summit follows a narrow ridge. The 15,000-foot Rupal Face, a single wall of rock and ice, is located on the mountain's southern side. Climbers have dubbed the Nanga Parbat, which (3)_____ as 'naked mountain', 'Killer Mountain'. This gives Annapurna a (4)_____ of 32%, making it the most statistically dangerous of the world's 8,000-metre peaks. It is an avalanche-prone area with some technical difficulty. Climbers' misery is (5)_____ by insufficient local support, in addition to unpredictable weather and inaccessibility.

SubQuestion No : 21

Q.21 Select the most appropriate option to fill in blank number 1.

Ans A). deepest B). lengthiest C). highest D). fattest

Correct Answer: C

Comprehension:

In the following passage, some words have been deleted. Read the passage carefully and select the most appropriate option to fill in each blank.

In terms of technical difficulty, Nanga Parbat, the world's ninth (1)_____ peak, competes with K2. The first (2)_____ to the summit follows a narrow ridge. The 15,000-foot Rupal Face, a single wall of rock and ice, is located on the mountain's southern side. Climbers have dubbed the Nanga Parbat, which (3)_____ as 'naked mountain', 'Killer Mountain'. This gives Annapurna a (4)_____ of 32%, making it the most statistically dangerous of the world's 8,000-metre peaks. It is an avalanche-prone area with some technical difficulty. Climbers' misery is (5)_____ by insufficient local support, in addition to unpredictable weather and inaccessibility.

SubQuestion No : 22

Q.22 Select the most appropriate option to fill in blank number 2.

Ans A). rise B). ascent C). lift D). launch

Correct Answer: B

Comprehension:

In the following passage, some words have been deleted. Read the passage carefully and select the most appropriate option to fill in each blank.

In terms of technical difficulty, Nanga Parbat, the world's ninth (1)_____ peak, competes with K2. The first (2)_____ to the summit follows a narrow ridge. The 15,000-foot Rupal Face, a single wall of rock and ice, is located on the mountain's southern side. Climbers have dubbed the Nanga Parbat, which (3)_____ as 'naked mountain', 'Killer Mountain'. This gives Annapurna a (4)_____ of 32%, making it the most statistically dangerous of the world's 8,000-metre peaks. It is an avalanche-prone area with some technical difficulty. Climbers' misery is (5)_____ by insufficient local support, in addition to unpredictable weather and inaccessibility.

SubQuestion No : 23

Q.23 Select the most appropriate option to fill in blank number 3.

Ans A). transliterates B). transposed C). translates D). transcribes

Correct Answer: C

Comprehension:

In the following passage, some words have been deleted. Read the passage carefully and select the most appropriate option to fill in each blank.

In terms of technical difficulty, Nanga Parbat, the world's ninth (1)_____ peak, competes with K2. The first (2)_____ to the summit follows a narrow ridge. The 15,000-foot Rupal Face, a single wall of rock and ice, is located on the mountain's southern side. Climbers have dubbed the Nanga Parbat, which (3)_____ as 'naked mountain', 'Killer Mountain'. This gives Annapurna a (4)_____ of 32%, making it the most statistically dangerous of the world's 8,000-metre peaks. It is an avalanche-prone area with some technical difficulty. Climbers' misery is (5)_____ by insufficient local support, in addition to unpredictable weather and inaccessibility.

SubQuestion No : 24

Q.24 Select the most appropriate option to fill in blank number 4.

Ans A). economic rate B). frailty rate C). fatality rate D). mortal rate

Correct Answer: C

Comprehension:

In the following passage, some words have been deleted. Read the passage carefully and select the most appropriate option to fill in each blank.

In terms of technical difficulty, Nanga Parbat, the world's ninth (1)_____ peak, competes with K2. The first (2)_____ to the summit follows a narrow ridge. The 15,000-foot Rupal Face, a single wall of rock and ice, is located on the mountain's southern side. Climbers have dubbed the Nanga Parbat, which (3)_____ as 'naked mountain', 'Killer Mountain'. This gives Annapurna a (4)_____ of 32%, making it the most statistically dangerous of the world's 8,000-metre peaks. It is an avalanche-prone area with some technical difficulty. Climbers' misery is (5)_____ by insufficient local support, in addition to unpredictable weather and inaccessibility.

SubQuestion No : 25

Q.25 Select the most appropriate option to fill in blank number 5.

Ans A). perfectly B). increasingly C). exacerbated D). worst

Correct Answer: C